Name: _____ Date: _____

Telling Time to the Nearest Minute

Grade 3 | Reading analog clocks to the nearest minute | Version 1 of 10

Look at each clock. Read the hour hand, then count the minute marks. Write the time on the line.

1.



_____ : _____

2.



_____ : _____

3.

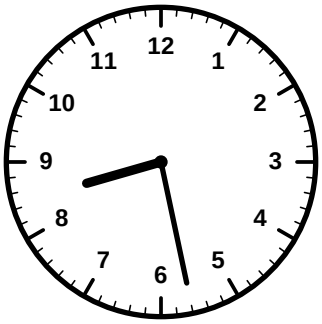

_____ : _____

4.



_____ : _____

5.

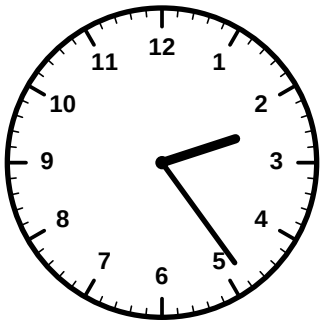

_____ : _____

6.

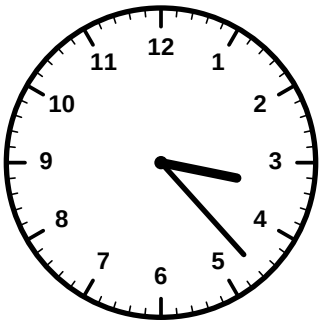

_____ : _____

7.



_____ : _____

8.



_____ : _____

9.



_____ : _____

10.



_____ : _____

11.



_____ : _____

12.

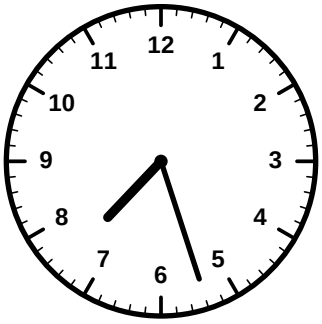

_____ : _____

Telling Time to the Nearest Minute - ANSWER KEY

Grade 3 | Reading analog clocks to the nearest minute | Version 1 of 10

Look at each clock. Read the hour hand, then count the minute marks. Write the time on the line.

1.



6:51

2.



10:23

3.

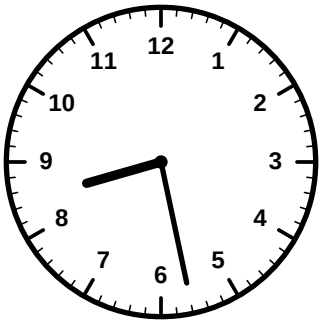

8:28

4.



11:34

5.

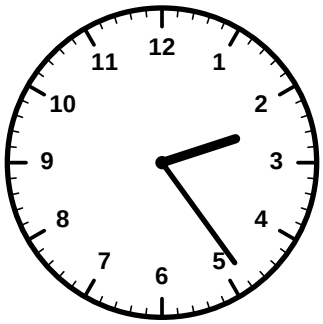

2:24

6.

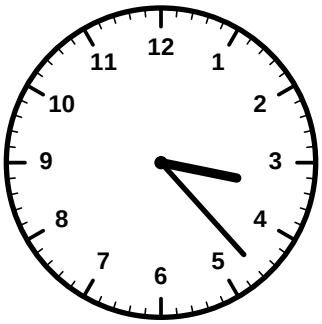

3:23

7.



12:28

8.



1:58

9.

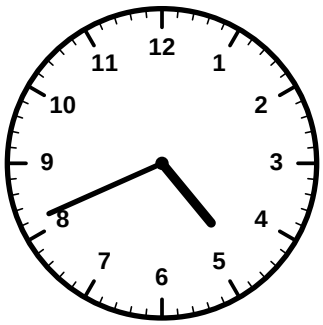

4:41

10.



9:18

11.



5:23

12.

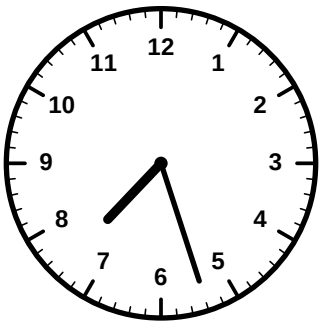

7:27