Name: _____ Date: _____

Telling Time to the Nearest Minute

Grade 3 | Reading analog clocks to the nearest minute | Version 9 of 10

Look at each clock. Read the hour hand, then count the minute marks. Write the time on the line.

1.



_____ : _____

2.

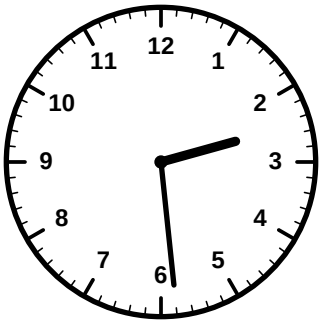

_____ : _____

3.



_____ : _____

4.



_____ : _____

5.



_____ : _____

6.



_____ : _____

7.



_____ : _____

8.

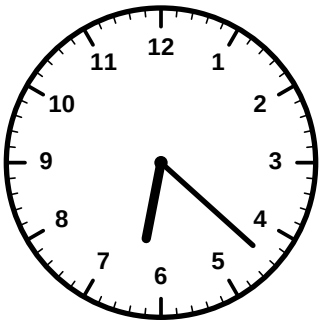

_____ : _____

9.



_____ : _____

10.



_____ : _____

11.



_____ : _____

12.

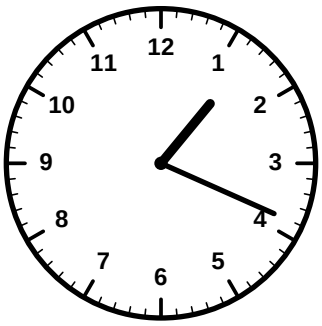

_____ : _____

Telling Time to the Nearest Minute - ANSWER KEY

Grade 3 | Reading analog clocks to the nearest minute | Version 9 of 10

Look at each clock. Read the hour hand, then count the minute marks. Write the time on the line.

1.



4:19

2.

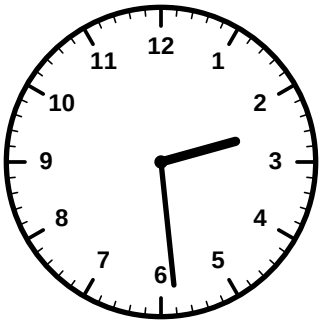

2:29

3.



5:56

4.



10:19

5.



7:08

6.



8:51

7.



9:48

8.

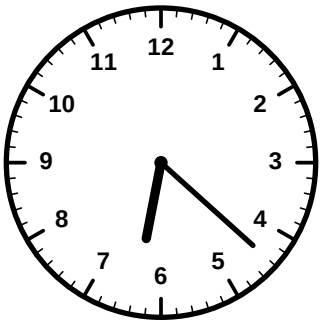

6:22

9.



3:56

10.



12:33

11.



11:04

12.



1:19