Name: _____ Date: _____

Telling Time to the Nearest Minute

Grade 3 | Reading analog clocks to the nearest minute | Version 7 of 10

Look at each clock. Read the hour hand, then count the minute marks. Write the time on the line.

1.



_____ : _____

2.



_____ : _____

3.



_____ : _____

4.

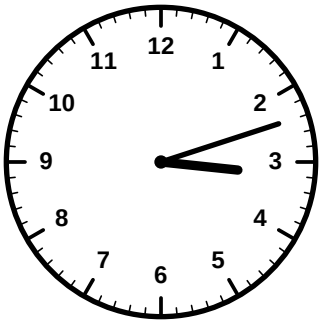

_____ : _____

5.

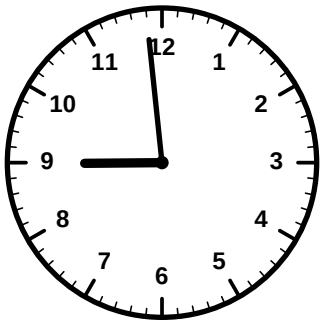

_____ : _____

6.



_____ : _____

7.



_____ : _____

8.

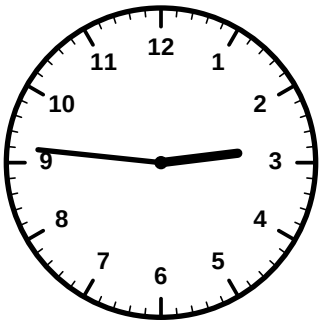

_____ : _____

9.



_____ : _____

10.



_____ : _____

11.



_____ : _____

12.



_____ : _____

Telling Time to the Nearest Minute - ANSWER KEY

Grade 3 | Reading analog clocks to the nearest minute | Version 7 of 10

Look at each clock. Read the hour hand, then count the minute marks. Write the time on the line.

1.



1:02

2.



9:26

3.



5:11

4.

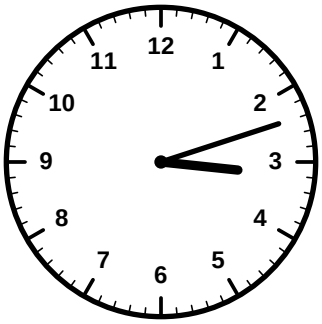

3:12

5.

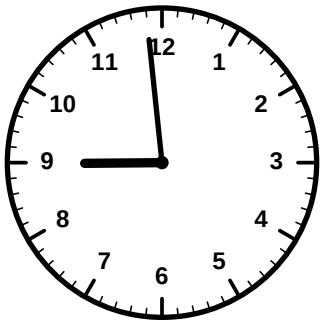

8:59

6.



7:03

7.



11:31

8.

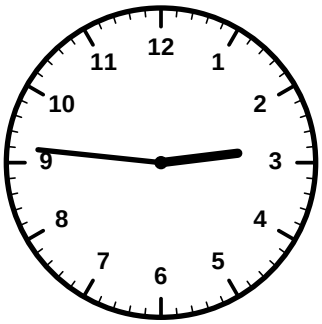

2:46

9.



6:53

10.



4:22

11.



10:49

12.



12:02