Name: _____ Date: _____

Telling Time to the Nearest Minute

Grade 3 | Reading analog clocks to the nearest minute | Version 6 of 10

Look at each clock. Read the hour hand, then count the minute marks. Write the time on the line.

1.



_____ : _____

2.

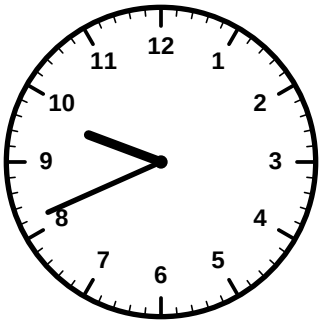

_____ : _____

3.



_____ : _____

4.



_____ : _____

5.

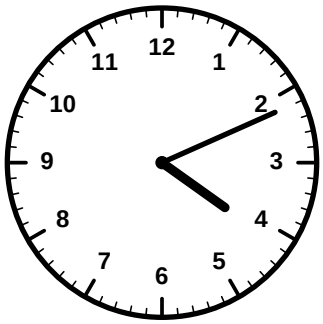

_____ : _____

6.

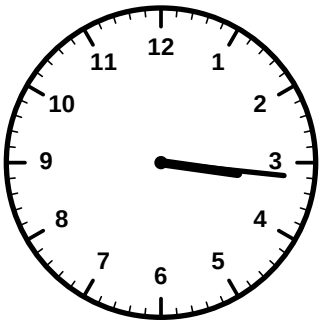

_____ : _____

7.

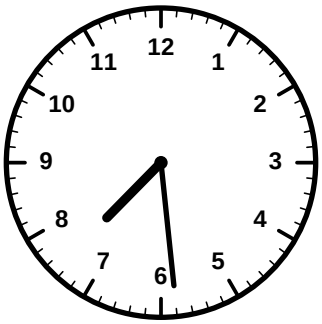

_____ : _____

8.

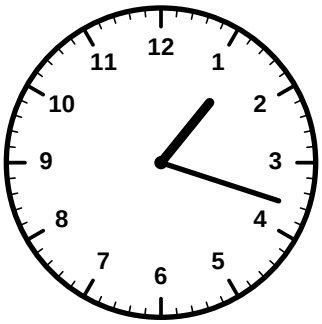

_____ : _____

9.



_____ : _____

10.

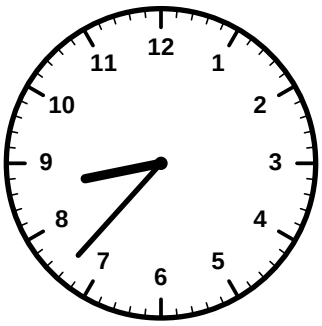

_____ : _____

11.

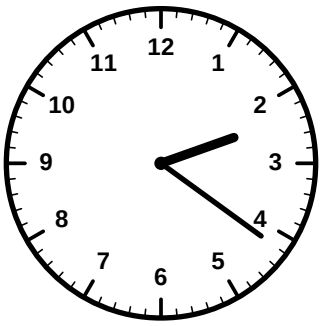

_____ : _____

12.

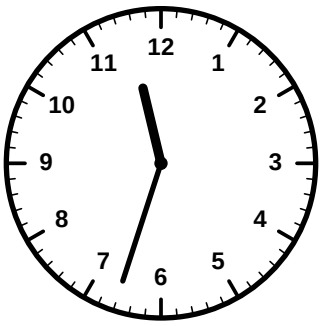

_____ : _____

Telling Time to the Nearest Minute - ANSWER KEY

Grade 3 | Reading analog clocks to the nearest minute | Version 6 of 10

Look at each clock. Read the hour hand, then count the minute marks. Write the time on the line.

1.



12:19

2.

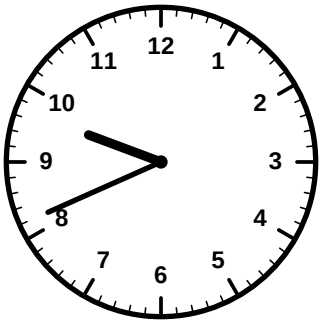

9:41

3.



10:17

4.



6:31

5.

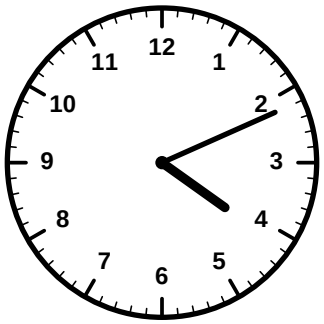

4:11

6.

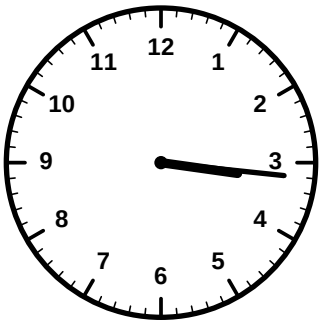

3:16

7.

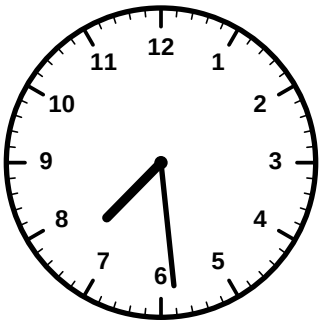

7:29

8.

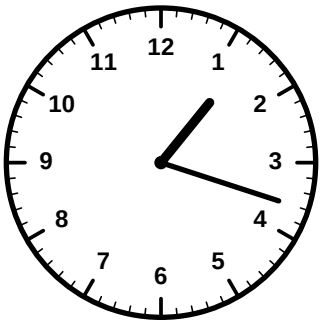

1:18

9.



5:18

10.

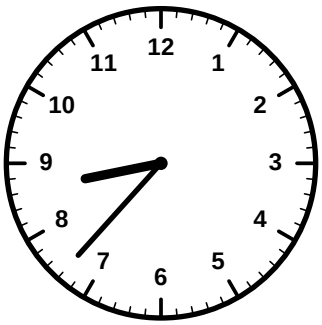

8:37

11.

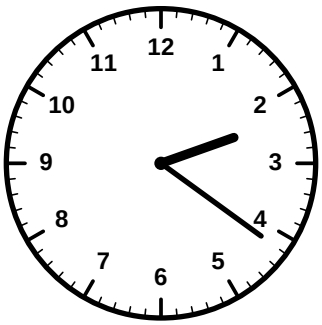

2:21

12.



11:33