Name: _____ Date: _____

Telling Time to the Nearest Minute

Grade 3 | Reading analog clocks to the nearest minute | Version 5 of 10

Look at each clock. Read the hour hand, then count the minute marks. Write the time on the line.

1.



_____ : _____

2.



_____ : _____

3.



_____ : _____

4.



_____ : _____

5.



_____ : _____

6.

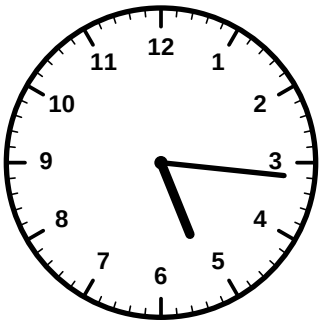

_____ : _____

7.

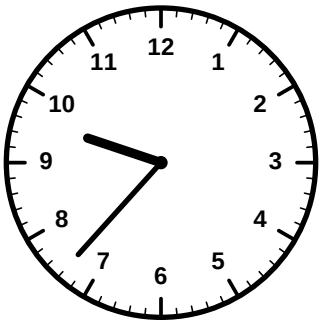

_____ : _____

8.

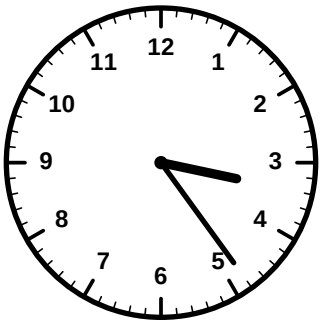

_____ : _____

9.

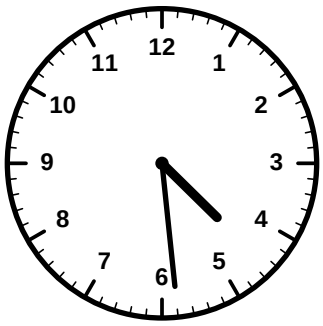

_____ : _____

10.



_____ : _____

11.



_____ : _____

12.

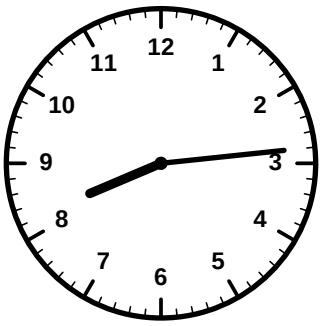

_____ : _____

Telling Time to the Nearest Minute - ANSWER KEY

Grade 3 | Reading analog clocks to the nearest minute | Version 5 of 10

Look at each clock. Read the hour hand, then count the minute marks. Write the time on the line.

1.



11:11

2.



12:52

3.



7:07

4.



6:33

5.



1:32

6.

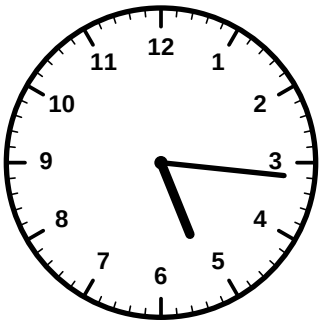

5:16

7.

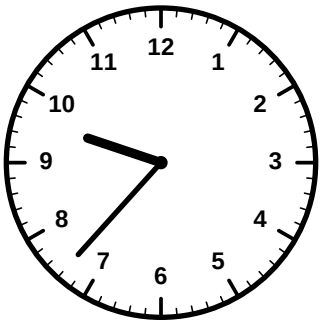

9:37

8.

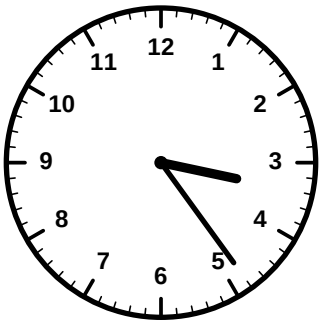

3:24

9.

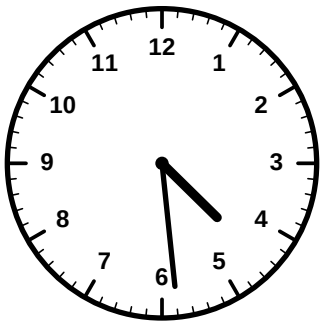

4:29

10.



2:13

11.



10:58

12.

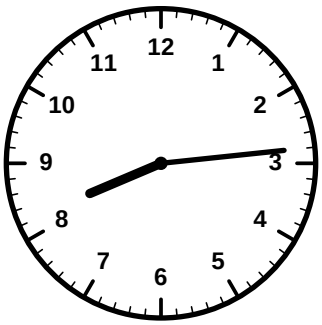

8:14