Name: _____ Date: _____

Telling Time to the Nearest Minute

Grade 3 | Reading analog clocks to the nearest minute | Version 4 of 10

Look at each clock. Read the hour hand, then count the minute marks. Write the time on the line.

1.

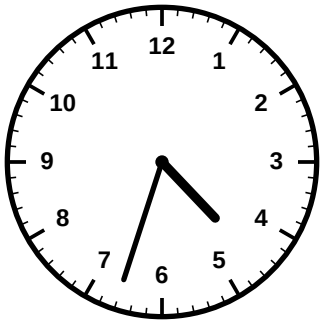

_____ : _____

2.

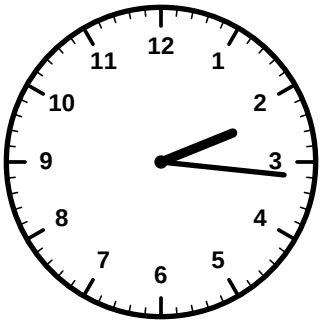

_____ : _____

3.

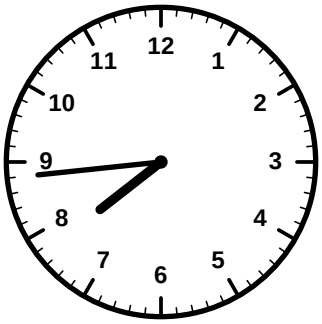

_____ : _____

4.

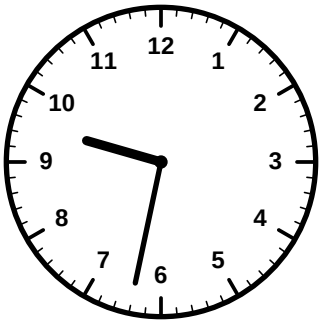

_____ : _____

5.

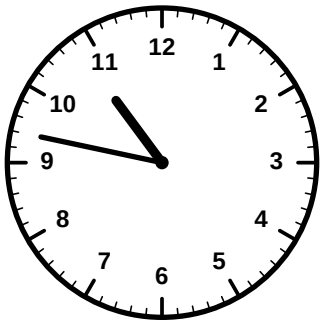

_____ : _____

6.

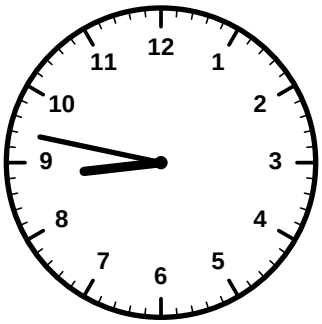

_____ : _____

7.

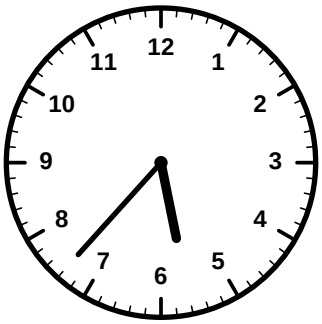

_____ : _____

8.



_____ : _____

9.



_____ : _____

10.



_____ : _____

11.



_____ : _____

12.



_____ : _____

Telling Time to the Nearest Minute - ANSWER KEY

Grade 3 | Reading analog clocks to the nearest minute | Version 4 of 10

Look at each clock. Read the hour hand, then count the minute marks. Write the time on the line.

1.

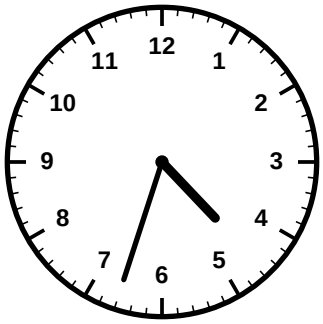

4:33

2.

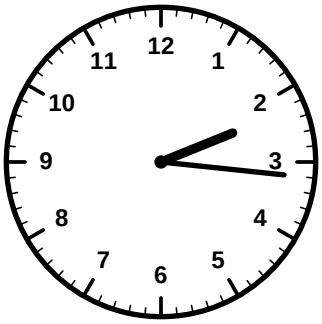

2:16

3.

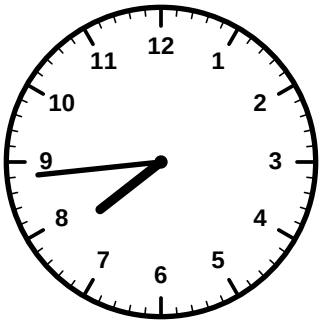

7:44

4.

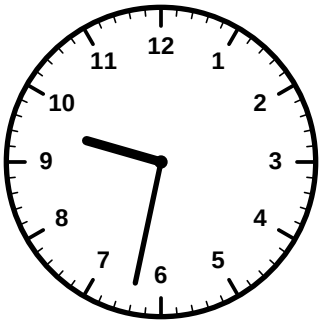

9:32

5.

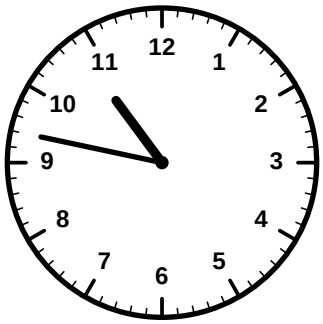

10:47

6.

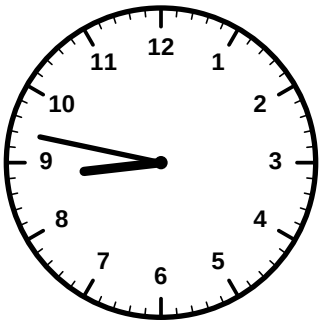

8:47

7.

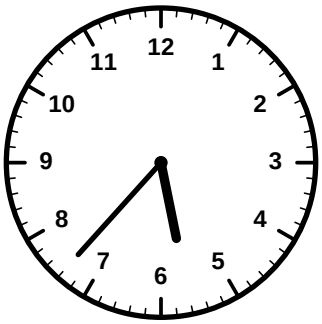

5:37

8.



1:41

9.

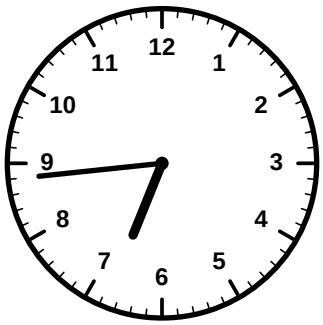

6:44

10.



12:09

11.



3:03

12.



11:24