Name: _____ Date: _____

Telling Time to the Nearest Minute

Grade 3 | Reading analog clocks to the nearest minute | Version 3 of 10

Look at each clock. Read the hour hand, then count the minute marks. Write the time on the line.

1.



_____ : _____

2.



_____ : _____

3.



_____ : _____

4.

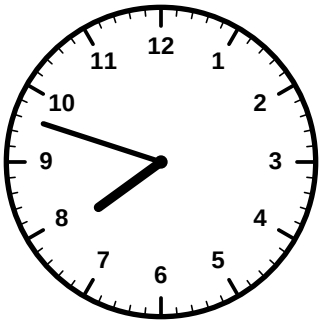

_____ : _____

5.

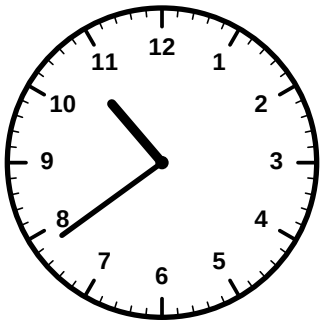

_____ : _____

6.

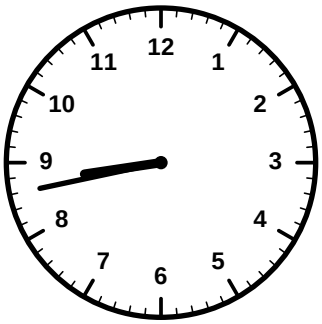

_____ : _____

7.

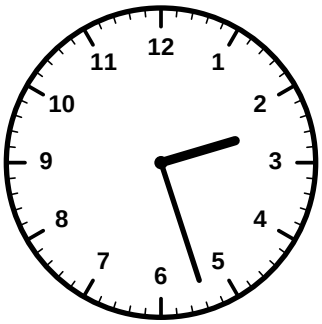

_____ : _____

8.

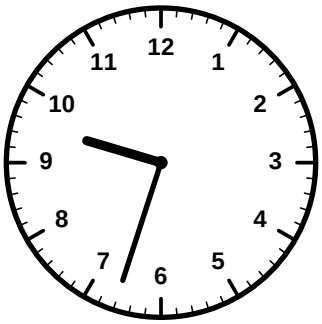

_____ : _____

9.

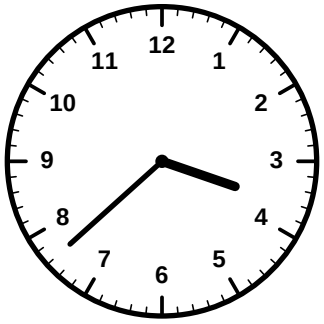

_____ : _____

10.



_____ : _____

11.

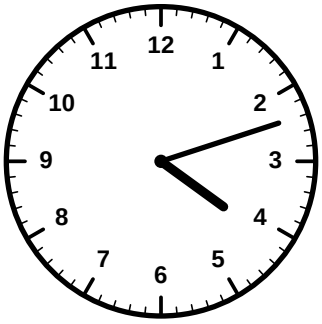

_____ : _____

12.



_____ : _____

Telling Time to the Nearest Minute - ANSWER KEY

Grade 3 | Reading analog clocks to the nearest minute | Version 3 of 10

Look at each clock. Read the hour hand, then count the minute marks. Write the time on the line.

1.



5:36

2.



6:32

3.



12:38

4.

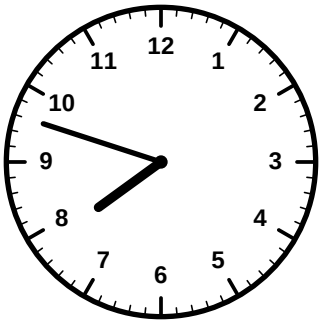

7:48

5.

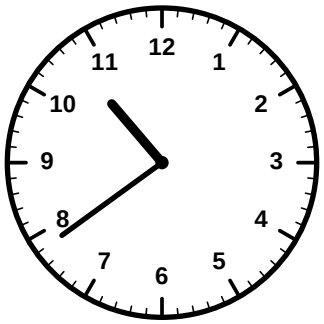

10:39

6.

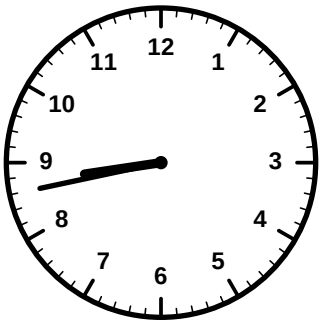

8:43

7.

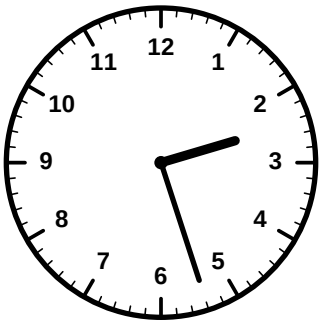

2:27

8.

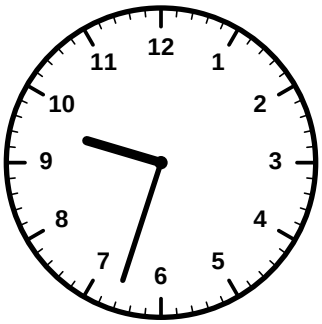

9:33

9.

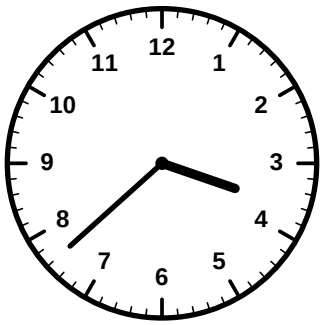

3:38

10.



11:58

11.

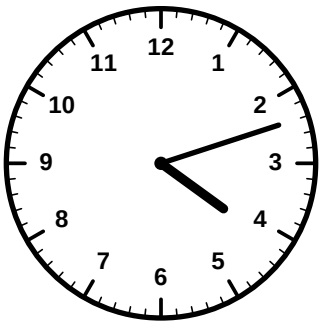

4:12

12.



1:04