Name: _____ Date: _____

Telling Time to the Nearest Minute

Grade 3 | Reading analog clocks to the nearest minute | Version 2 of 10

Look at each clock. Read the hour hand, then count the minute marks. Write the time on the line.

1.

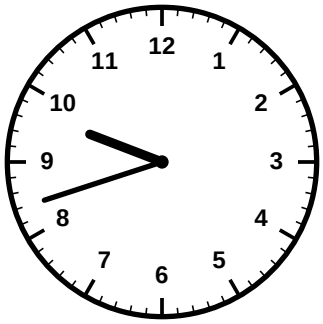

_____ : _____

2.



_____ : _____

3.



_____ : _____

4.

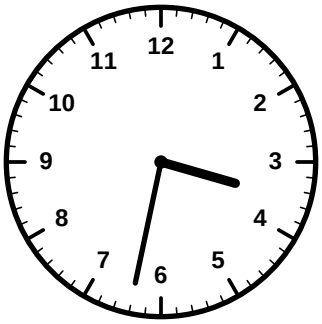

_____ : _____

5.



_____ : _____

6.



_____ : _____

7.

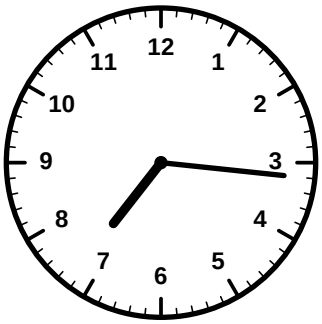

_____ : _____

8.

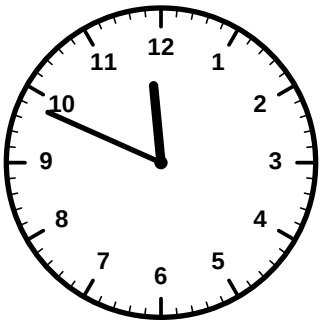

_____ : _____

9.



_____ : _____

10.



_____ : _____

11.

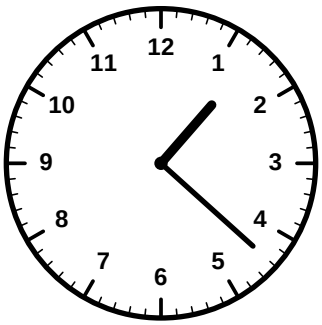

_____ : _____

12.



_____ : _____

Telling Time to the Nearest Minute - ANSWER KEY

Grade 3 | Reading analog clocks to the nearest minute | Version 2 of 10

Look at each clock. Read the hour hand, then count the minute marks. Write the time on the line.

1.

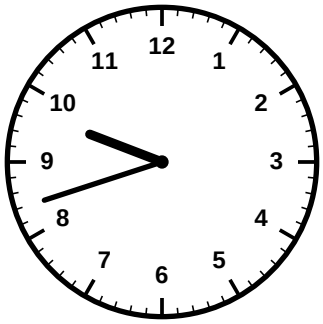

9:42

2.



6:57

3.



10:28

4.

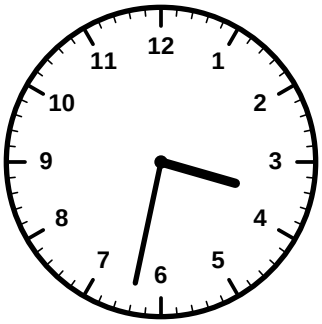

3:32

5.



2:56

6.



8:26

7.

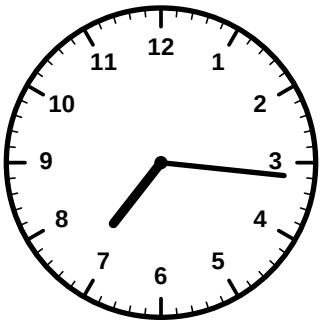

7:16

8.

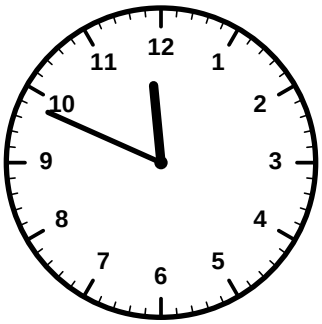

11:49

9.



5:53

10.



12:56

11.

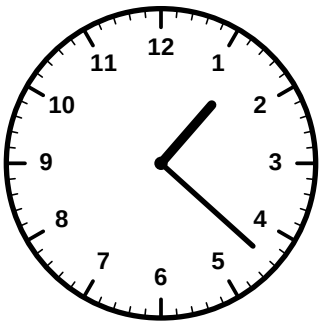

1:22

12.



4:06