Name: _____ Date: _____

Telling Time to the Nearest Minute

Grade 3 | Reading analog clocks to the nearest minute | Version 10 of 10

Look at each clock. Read the hour hand, then count the minute marks. Write the time on the line.

1.



_____ : _____

2.



_____ : _____

3.



_____ : _____

4.

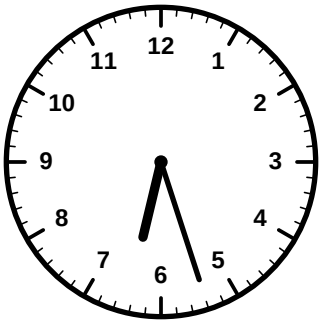

_____ : _____

5.

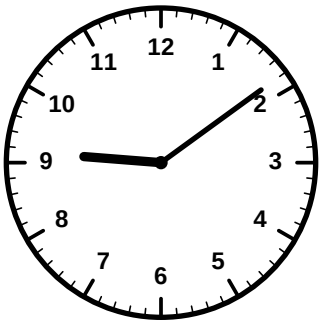

_____ : _____

6.

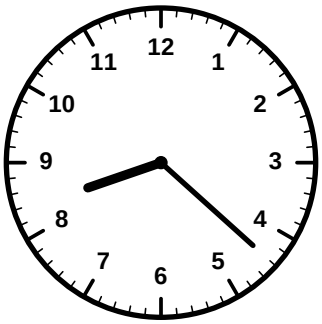

_____ : _____

7.



_____ : _____

8.



_____ : _____

9.

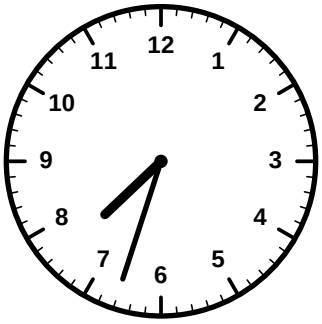

_____ : _____

10.



_____ : _____

11.



_____ : _____

12.



_____ : _____

Telling Time to the Nearest Minute - ANSWER KEY

Grade 3 | Reading analog clocks to the nearest minute | Version 10 of 10

Look at each clock. Read the hour hand, then count the minute marks. Write the time on the line.

1.



12:32

2.



2:39

3.



3:01

4.

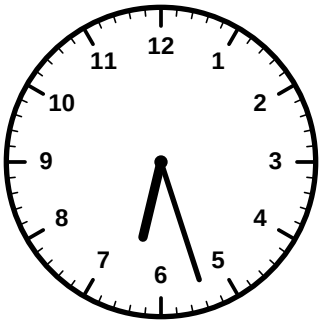

6:27

5.

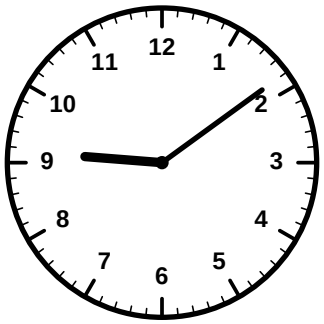

9:09

6.

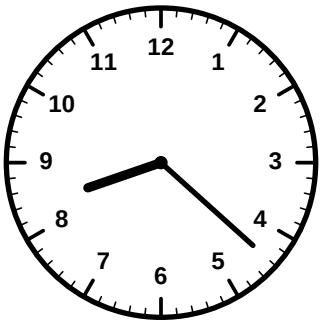

8:22

7.



1:34

8.



11:07

9.

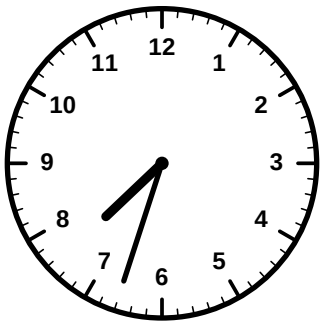

7:33

10.



4:01

11.



10:02

12.



5:22